Computing Areas and Perimeters of Simple Figures

Answer Key

Find the area of each of the figures below. The figures were drawn on a grid whose horizontal and vertical segments are all 3 cm long.

1.

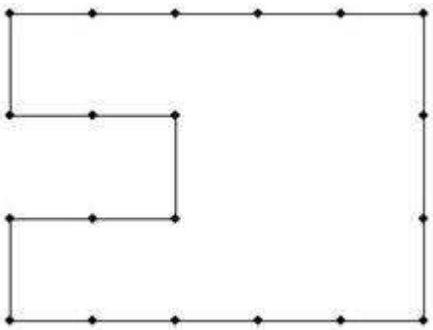

A = 117, *P* = 60

2.

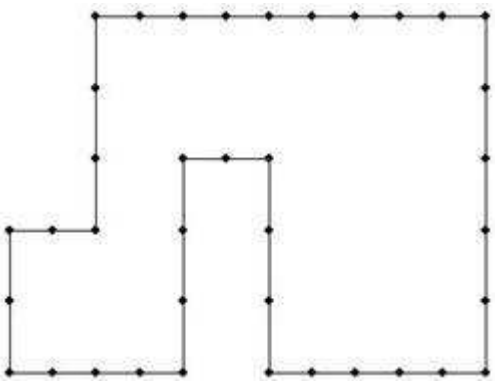

A = 387, *P* = 114

3.

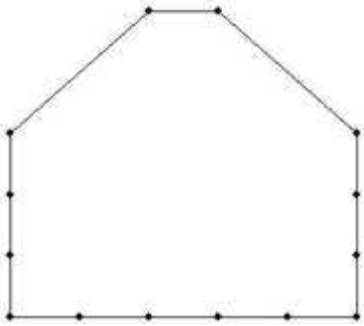

A = 189

4.



A = 54

5.

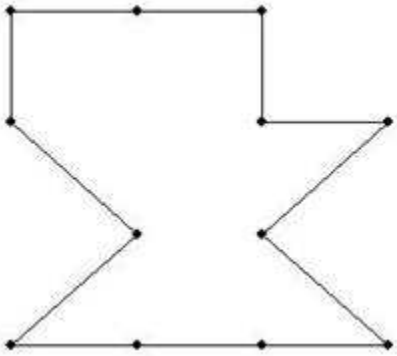

A = 54